Mapas topográficos 2º test. CÓDIGO DEL ALUMNO_____GRUPO 1º___ MODELO 1

1- ¿Cuál es el perfil correcto del trayecto desde A hasta C?

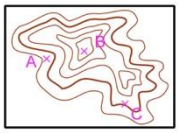

Perfil A → C

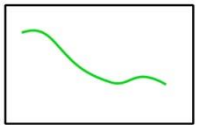

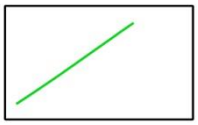



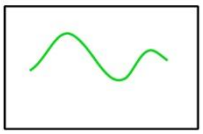

1	
2	
3	
4	
No sé	

2- ¿Cuál es la ruta más corta para ir desde A hasta B sin subir ni bajar?

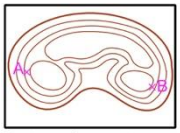

Ruta más corta para ir desde A hasta B sin subir ni bajar

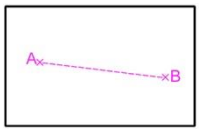



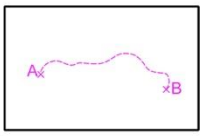



1	
2	
3	
4	
No sé	

3- ¿Cuál es el perfil correcto del trayecto desde A hasta B?

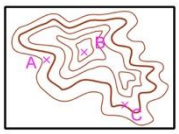

Perfil A → B

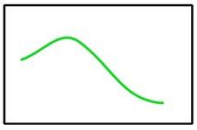

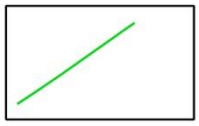





1	
2	
3	
4	
No sé	

4- ¿Cuál es la representación correcta en curvas de nivel?

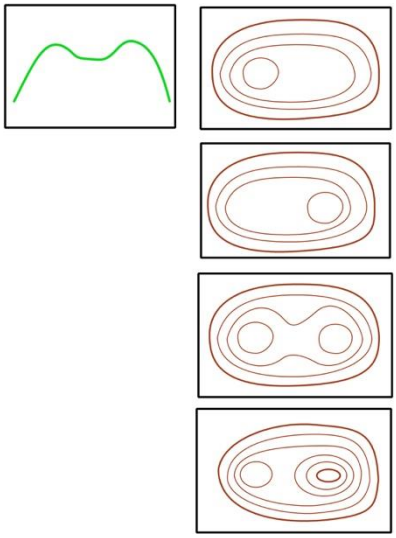

1	
2	
3	
4	
No sé	

5- ¿Cuál es la representación correcta en curvas de nivel?

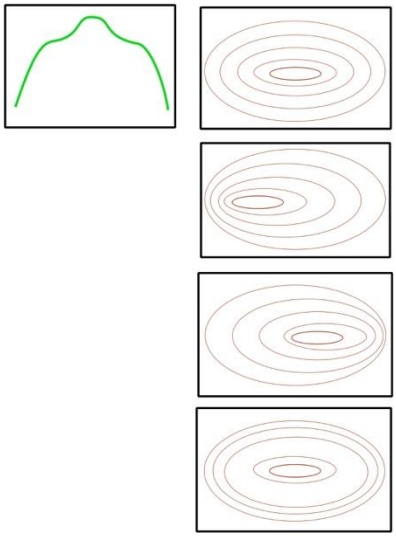

1	
2	
3	
4	
No sé	

6- ¿Cuál es la representación correcta?

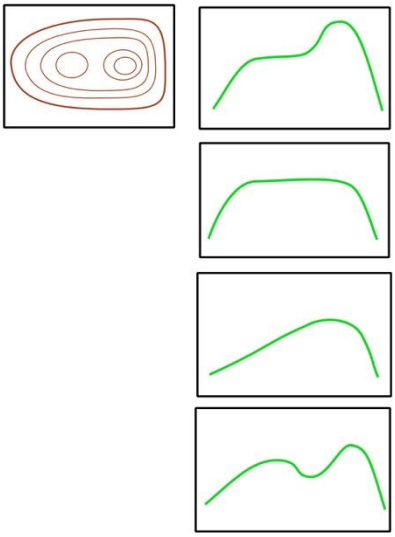

1	
2	
3	
4	
No sé	

7- ¿Cuál es la representación correcta?

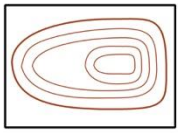

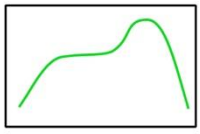

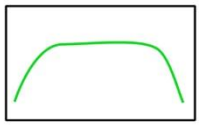

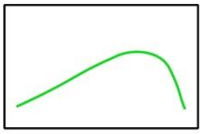

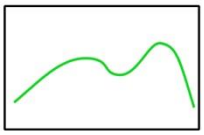

1	
2	
3	
4	
No sé	

8- ¿Cuál es el perfil correcto del C?

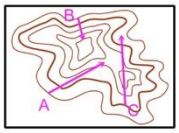

Perfil de C

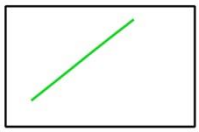



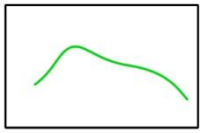



1	
2	
3	
4	
No sé	

9- ¿Cuál es la representación correcta en curvas de nivel?

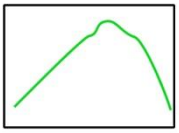

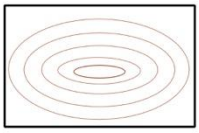

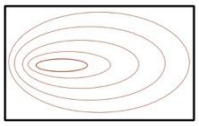

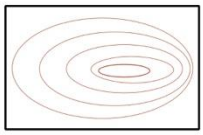

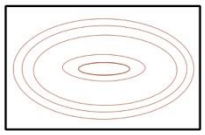

1	
2	
3	
4	
No sé	

10- ¿Cuál es la representación correcta en curvas de nivel?

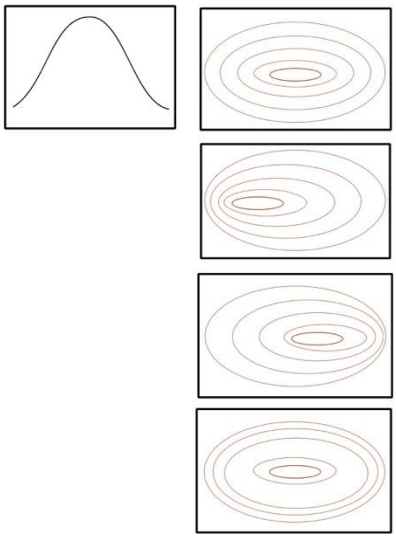

1	
2	
3	
4	
No sé	

11- ¿Cuál es la representación correcta en curvas de nivel?

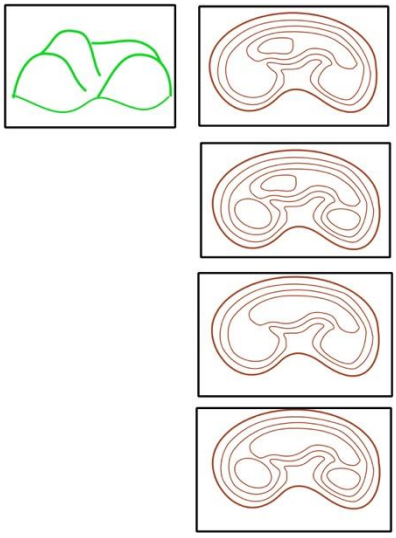

1	
2	
3	
4	
No sé	

12- ¿Cuál es la representación correcta en curvas de nivel?

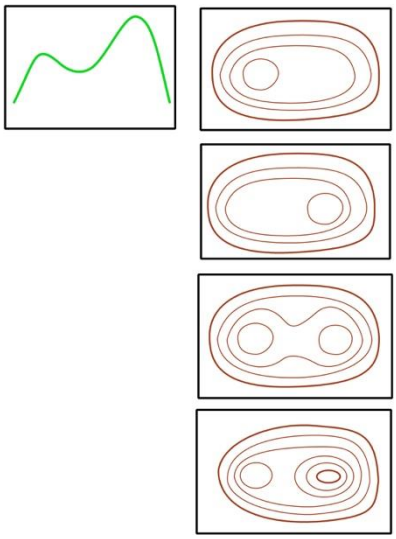

1	
2	
3	
4	
No sé	

13- En la siguiente representación, los tres individuos (A, B y C) ¿se ven entre ellos?

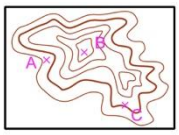

¿Se ven entre ellos?

- No
- Sí
- A y B sí
  C con nadie
- A y C sí
  B con nadie
- A y C no
  B con todos

1	
2	
3	
4	
5	
No sé	

14- ¿Cuál es la representación correcta?

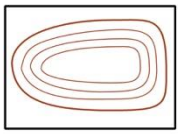

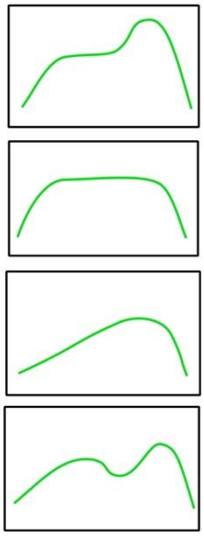

1	
2	
3	
4	
No sé	

15- ¿Cuál es la ruta más corta para ir desde A hasta B sin subir ni bajar?

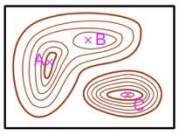

Ruta más corta para ir desde A hasta B sin subir ni bajar

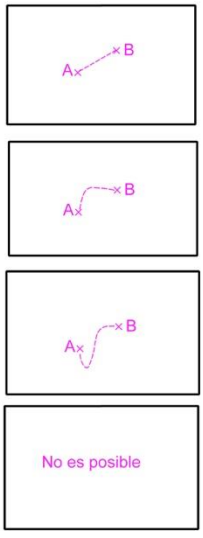

1	
2	
3	
4	
No sé	

16- ¿Cuál es la representación correcta en curvas de nivel?

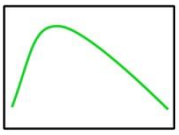

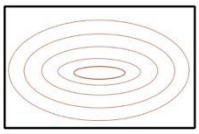

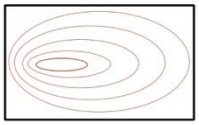

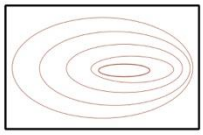

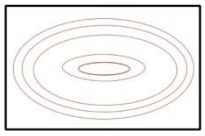

1	
2	
3	
4	
No sé	

17- ¿Quién tiene más pendiente?

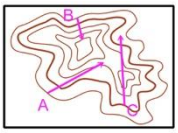

¿Quién tiene más pendiente?

A más que B y C

B más que A y C

C más que A y B

A y C mas que B

1	
2	
3	
4	
No sé	

18- ¿Cuál es el perfil de A?

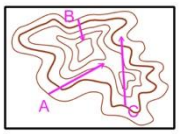

Perfil de A

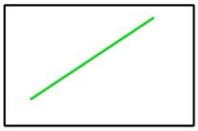







1	
2	
3	
4	
No sé	

19- Si sigo las flechas…¿qué ocurre?

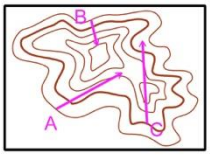

Si sigo las flechas...

A, B y C suben

A y C suben
B baja

A y B suben
C baja

C sube y baja
A y B suben

Ninguna es correcta

1	
2	
3	
4	
5	
No sé	

20- ¿Cuál es la representación correcta en curvas de nivel?

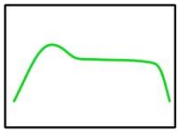

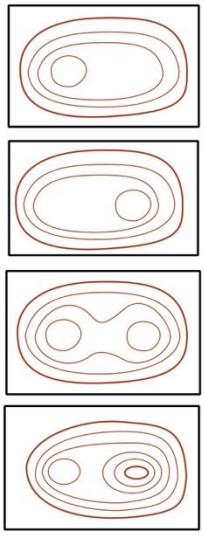

1	
2	
3	
4	
No sé	

21- ¿Cuál es la representación correcta en curvas de nivel?

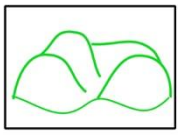

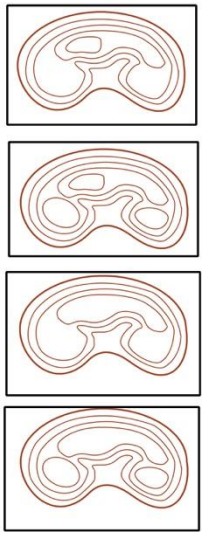

1	
2	
3	
4	
No sé	

22- ¿Cuál es el perfil de B?

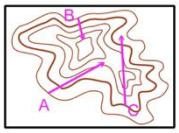

Perfil de B

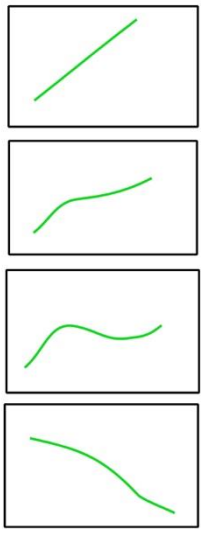

1	
2	
3	
4	
No sé	

23- ¿Cuál es la representación correcta?

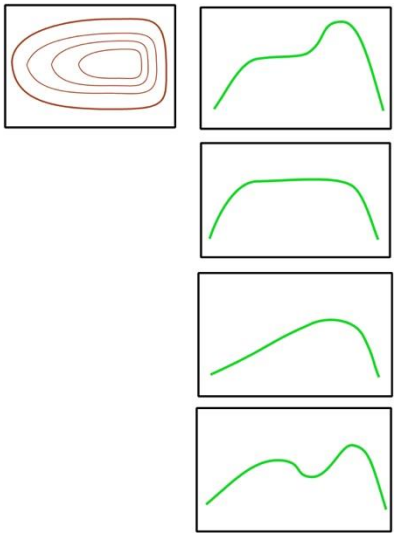

1	
2	
3	
4	
No sé	

24- ¿Cuál es la representación correcta en curvas de nivel?

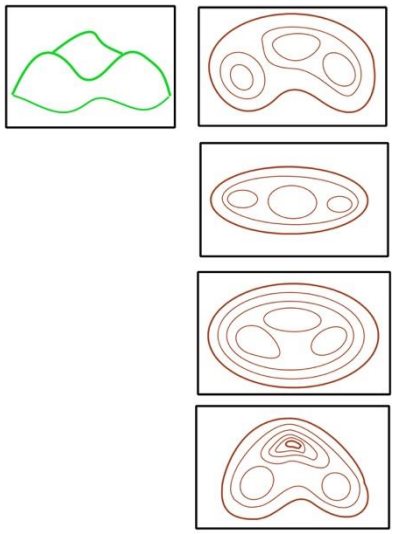

1	
2	
3	
4	
No sé	

25- ¿Cuál es el perfil desde A hasta C pasando por B?

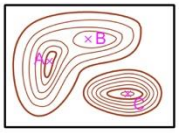

Perfil desde A hasta C pasando por B

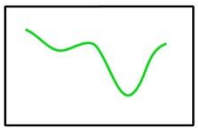

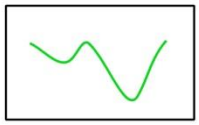

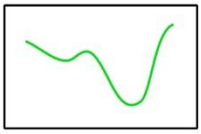

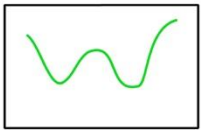

1	
2	
3	
4	
No sé	

26- ¿Quién sube más?

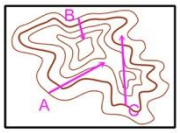

¿Quien sube más?

A más que B y C

B más que A y C

C más que A y B

A y C mas que B

1	
2	
3	
4	
No sé	

27- ¿Cuál es la representación correcta en curvas de nivel?

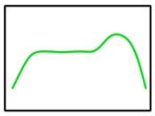

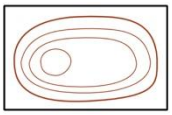

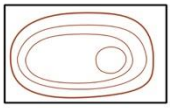

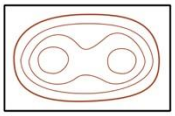

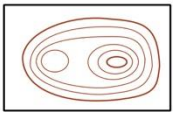

1	
2	
3	
4	
No sé	

28- Selecciona la opción correcta

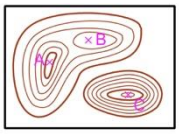

A está más alto que B y C

B está más alto que A y C

C está más alto que A y B

A, B y C están en cimas de la misma altura

1	
2	
3	
4	
No sé	

29- ¿Quién está más alto?

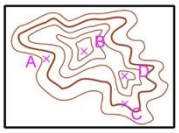

Quien está más alto

B está mas arriba que el resto

B y D están en cimas

B es el que más arriba está y puede ver al resto

Todas las anteriores son correctas

1	
2	
3	
4	
No sé	

30- Selecciona el perfil correcto

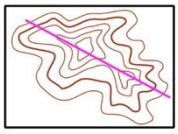

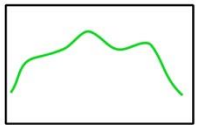

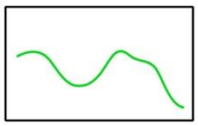

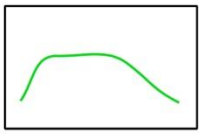

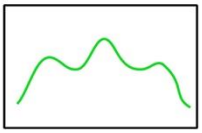

1	
2	
3	
4	
No sé	